Name : _____

Measuring Angles - Revision

Sheet 3

A) Measure each angle using a protractor.

1)

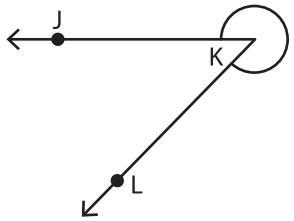

2)

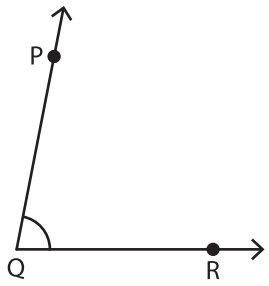

3)

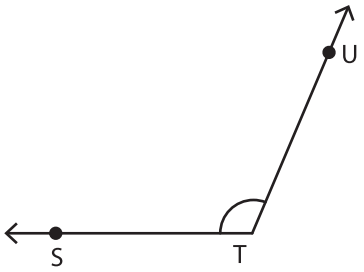

m∠JKL = _____ STU = _____

B) Find the angle forme dicated angle using a and minute hands of

1)

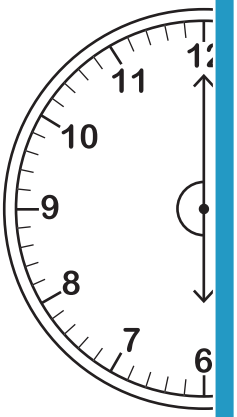

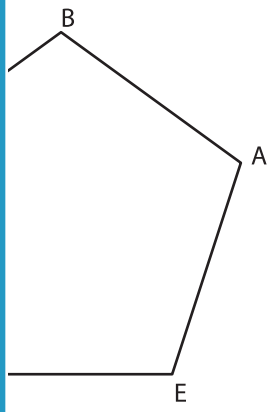

Angle: _____ _____

2)

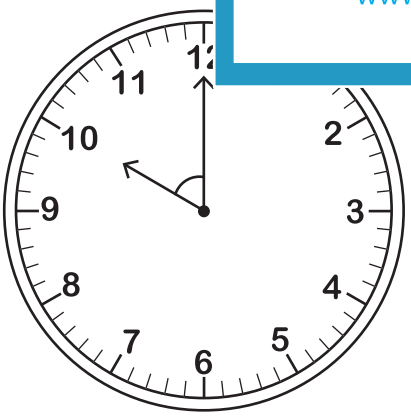



Angle: _____

m∠KLM = _____

PREVIEW

Gain complete access to the largest collection of worksheets in all subjects!

Members, please log in to download this worksheet.

Not a member? Please sign up to gain complete access.

www.mathworksheets4kids.com