Name : _____

DS5

Area

Find the area of each circle. Round your answer to two decimal palces. (use π = 3.14)

1)

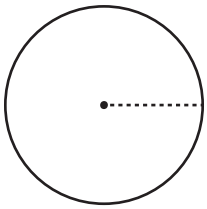

Circumference = 59.28 in

Area = _____

2)

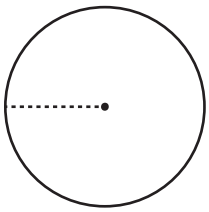

Circumference = 85.6 yd

3)

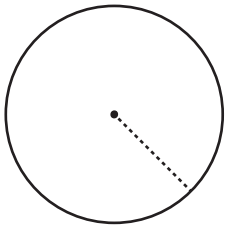

Circumference = 69.77 ft

ea = _____

4)

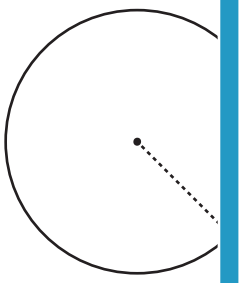

Circumference = 75

Area = _____

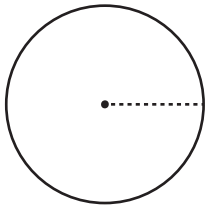

cumference = 105.32 yd

ea = _____

PREVIEW

Gain complete access to the largest collection of worksheets in all subjects!

Members, please log in to download this worksheet.

Not a member? Please sign up to gain complete access.

www.mathworksheets4kids.com

7) Chad said the l ion. What is the area of the wheel? F .14)

Area = _____

8) The circumference of a circular horse pen is 94.24 ft. What is the area of the pen? Round your answer to two decimal places. (use π = 3.14)

Area = _____