Name : _____

Volume - Rectangular Prism

Decimals: S2

A) Find the volume of each rectangular prism. Round your answer to two decimal places.

1)

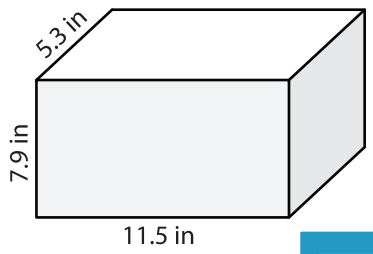

2)

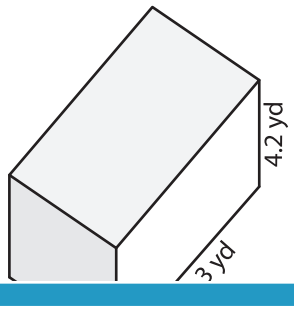

3)

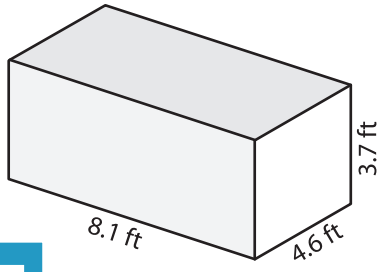

Volume = _____ ume = _____

B) Find the volume of e eters. Round your answer to two decim

4) height = 7 yd ; width = th = 10 in ; height = 12.3 in

Volume = _____ _____

6) length = 16.1 ft ; width = ngth = 9.8 yd ; width = 6.2 yd

Volume = _____ Volume = _____

8) A rectangular prism has a length of 4.9 inches, a width of 3.5 inches and a height of 2 inches. What is the volume of the prism?

_____

PREVIEW

Gain complete access to the largest collection of worksheets in all subjects!

Members, please log in to download this worksheet.

Not a member? Please sign up to gain complete access.

www.mathworksheets4kids.com